Name: _____

Sr: 12122023-3407

December 12, 2023

MATHS WORKSHEET GENERATOR 11-PLUS SATS GCSES

1) $\frac{15}{4} \div \frac{19}{12}$

Answer: _____

2) 88.6 - 84.1

Answer: _____

3) 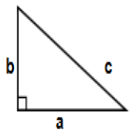

Find area of triangle
a = 97 m, b = 99 m

Answer: _____

4) 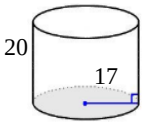

Find Volume of Cylinder

Answer: _____

5) 20 ÷ (-20)

Answer: _____

6) Simplify 12:4

Answer: _____

7) Find the mode of the following set of data:
17, 17, 17, 17, 35, 35, 9, 9, 9, 9

Answer: _____

8) 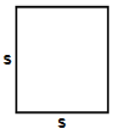

Find area of square having each side (s) equals 26 ft

Answer: _____

9) 09:16 am To 12:14 pm

Answer: _____

10) 81.34 ÷ 9.8

Answer: _____

11) Round 23.988219 to the nearest whole number.

Answer: _____

12) 12.7 + 11.7

Answer: _____

13) 09:38 am To 02:39 pm

Answer: _____

14) 09:38 am To 02:39 pm

Answer: _____

15) Simplify 9:7

Answer: _____

Copyright 2023 - Geek School Tutoring Limited

Name: _____

Sr: 12122023-3407

December 12, 2023

16) 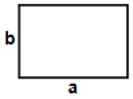

Find area of rectangle having sides a = 98 m and b = 95 m

Answer: _____

17) $^{4}/_{5} \div {}^{3}/_{9}$

Answer: _____

18) 86 - 62

Answer: _____

19) A number was shared in the ratio 1:19. The smaller share was 13. What was the total amount shared?

Answer: _____

20) $5^2 + 13 - 10$

Answer: _____

Total: ___ / 20

Copyright 2023 - Geek School Tutoring Limited

Name: _____

Sr: 12122023-3407

December 12, 2023

Answers:

1) $2^{7}/_{19}$	2) 4.5	3) 4801.5m	4) 18158.405537749	5) -1	6) 3 : 1	7) 17
8) 676ft	9) 02 Hours 58 Mins	10) 8.3	11) 24	12) 24.4	13) 05 Hours 01 Mins	14) 05 Hours 01 Mins
15) 9 : 7	16) 9310m	17) $2^{2}/_{5}$	18) 24	19) 260	20) 28	

Copyright 2023 - Geek School Tutoring Limited